Money

Problem:

Johnny has $20.00. If he spent $16.32 on a baseball glove. How much does Johnny have left?

Solution:

Johnny has $36.32.

What did Stevie do wrong? Why do you think he did that?

Solve the problem correctly. Draw a picture.

Explain to Stevie how you got the correct answer and why.

Money

Problem:

How many nickels are needed to make 25¢?

Solution:

25 nickels

What did Stevie do wrong?
Why do you think he did that?

Solve the problem correctly.
Draw a picture.

Explain to Stevie how you got the correct answer and why.

Money

Problem:

The State Fair was coming to town! Jamie's Mom gave her $4.50 and her Dad gave her $8.25. How much money does Jamie have for the State Fair?

Solution:

Johnny has $4.25 for the State Fair.

What did Stevie do wrong? Why do you think he did that?

Solve the problem correctly. Draw a picture.

Explain to Stevie how you got the correct answer and why.

Money

Problem:

Bobby was buying lollipops for his 2 friends. If each lollipop cost .25 cents, how much did Bobby spend?

Solution:

Bobby spent .75 cents.

What did Stevie do wrong?
Why do you think he did that?

Solve the problem correctly.
Draw a picture.

Explain to Stevie how you got the correct answer and why.

Money

Problem:

Harper has $2.25 for her chores on Monday and earned $1.75 for her chores on Tuesday. How much money did Harper earn for her chores in the two days?

Solution:

$2.25
+ $1.75
$23.25

What did Stevie do wrong? Why do you think he did that?

Solve the problem correctly. Draw a picture.

Explain to Stevie how you got the correct answer and why.

Money

Problem:

How many quarters equal to $1.00?

Solution:

.25¢
.25¢
.25¢
.25¢
+ .25¢

$1.00

What did Stevie do wrong?
Why do you think he did that?

Solve the problem correctly.
Draw a picture.

Explain to Stevie how you got the correct answer and why.

Money

Problem:

How much money is below?



Solution:

$30.52

What did Stevie do wrong? Why do you think he did that?

Solve the problem correctly. Draw a picture.

Explain to Stevie how you got the correct answer and why.

Money

Problem:

How much money is below?



Solution:

$3.03

What did Stevie do wrong? Why do you think he did that?

Solve the problem correctly. Draw a picture.

Explain to Stevie how you got the correct answer and why.

Money

Problem:

Stevie gave the money below to the cashier for his food. How much money did he spend on his food?

Solution:

$10.36

What did Stevie do wrong? Why do you think he did that?

Solve the problem correctly. Draw a picture.

Explain to Stevie how you got the correct answer and why.

Money

Problem:

If Jane gets $5 for each chore he does, how much money does he make for 4 chores?

Solution:

$10.00

What did Stevie do wrong?
Why do you think he did that?

Solve the problem correctly.
Draw a picture.

Explain to Stevie how you got the correct answer and why.

Money

Problem:

Katie was shopping for school supplies. What was the total of things Katie bought, if she bought two of each item?

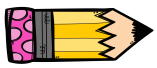 $1.99

$20.99

Solution:

$22.98

What did Stevie do wrong?
Why do you think he did that?

Solve the problem correctly.
Draw a picture.

Explain to Stevie how you got the correct answer and why.

Money

Problem:

Mrs. Hersh was buying 4 apples. What was the total amount Mrs. Hersh spent on apples?

$0.85

Solution:

$0.89

What did Stevie do wrong? Why do you think he did that?

Solve the problem correctly. Draw a picture.

Explain to Stevie how you got the correct answer and why.

Money

Problem:

Who has more money?

Jaylen **or** **Thomas**

Solution:

Thomas

What did Stevie do wrong?
Why do you think he did that?

Solve the problem correctly.
Draw a picture.

Explain to Stevie how you got the correct answer and why.

Money

Problem:

Jack has $1.05 but wants to buy a pack of gum for $1.50. How much more money does Jack need?

Solution:

Jack needs 55¢.

What did Stevie do wrong? Why do you think he did that?

Solve the problem correctly. Draw a picture.

Explain to Stevie how you got the correct answer and why.

Money

Problem:

Who has the least amount of money?

Bonnie

or

Dorothy

Solution:

Dorothy

What did Stevie do wrong?
Why do you think he did that?

Solve the problem correctly.
Draw a picture.

Explain to Stevie how you got the correct answer and why.

Money

Problem:

Show how to make 30¢.

Solution:

What did Stevie do wrong?
Why do you think he did that?

Solve the problem correctly.
Draw a picture.

Explain to Stevie how you got the correct answer and why.